Please write clearly in block capitals.

Centre number | | | | | | Candidate number | | | | |

Surname _____

Forename(s) _____

Candidate signature _____
I declare this is my own work.

AS
FURTHER MATHEMATICS

Paper 1

Monday 13 May 2024 Afternoon Time allowed: 1 hour 30 minutes

Materials
- You must have the AQA Formulae and statistical tables booklet for A-level Mathematics and A-level Further Mathematics.
- You should have a graphical or scientific calculator that meets the requirements of the specification.

Instructions
- Use black ink or black ball-point pen. Pencil should only be used for drawing.
- Fill in the boxes at the top of this page.
- Answer **all** questions.
- You must answer each question in the space provided for that question. If you require extra space for your answer(s), use the lined pages at the end of this book. Write the question number against your answer(s).
- Do **not** write outside the box around each page or on blank pages.
- Show all necessary working; otherwise marks for method may be lost.
- Do all rough work in this book. Cross through any work that you do not want to be marked.

Information
- The marks for questions are shown in brackets.
- The maximum mark for this paper is 80.

Advice
- Unless stated otherwise, you may quote formulae, without proof, from the booklet.
- You do not necessarily need to use all the space provided.

For Examiner's Use	
Question	Mark
1	
2	
3	
4	
5	
6	
7	
8	
9	
10	
11	
12	
13	
14	
15	
16	
17	
TOTAL	

Do not write outside the box

Answer **all** questions in the spaces provided.

1 Express $\cosh^2 x$ in terms of $\sinh x$

Circle your answer.

[1 mark]

$1 + \sinh^2 x$ $\quad$ $1 - \sinh^2 x$ $\quad$ $\sinh^2 x - 1$ $\quad$ $-1 - \sinh^2 x$

2 The function f is defined by

$$f(x) = 2x + 3 \qquad 0 \leq x \leq 5$$

The region *R* is enclosed by $y = f(x)$, $x = 5$, the x-axis and the y-axis.

The region *R* is rotated through 2π radians about the x-axis.

Give an expression for the volume of the solid formed.

Tick (✓) **one** box.

[1 mark]

$\pi\int_0^5 (2x + 3)\,dx$ ☐

$\pi\int_0^5 (2x + 3)^2\,dx$ ☐

$2\pi\int_0^5 (2x + 3)\,dx$ ☐

$2\pi\int_0^5 (2x + 3)^2\,dx$ ☐

Do not write outside the box

3 The matrix **A** is such that $\det(\mathbf{A}) = 2$

Determine the value of $\det(\mathbf{A}^{-1})$

Circle your answer.

[1 mark]

-2 $\quad$ $-\frac{1}{2}$ $\quad$ $\frac{1}{2}$ $\quad$ 2

4 The line L has vector equation

$$\mathbf{r} = \begin{bmatrix} 4 \\ -7 \\ 0 \end{bmatrix} + \lambda \begin{bmatrix} -9 \\ 1 \\ 3 \end{bmatrix}$$

Give the equation of L in Cartesian form.

Tick (✓) **one** box.

[1 mark]

$\frac{x+4}{-9} = \frac{y-7}{1} = \frac{z}{3}$ ☐

$\frac{x-4}{-9} = \frac{y+7}{1} = \frac{z}{3}$ ☐

$\frac{x+9}{4} = \frac{y-1}{-7}$, $z = 3$ ☐

$\frac{x-9}{4} = \frac{y+1}{-7}$, $z = 3$ ☐

Do not write outside the box

5 The vectors **a** and **b** are given by

$$\mathbf{a} = 3\mathbf{i} + 4\mathbf{j} - 2\mathbf{k} \qquad \text{and} \qquad \mathbf{b} = 2\mathbf{i} - \mathbf{j} - 5\mathbf{k}$$

5 (a) Calculate **a.b**

[1 mark]

5 (b) Calculate $|\mathbf{a}|$ and $|\mathbf{b}|$

[2 marks]

$|\mathbf{a}| =$ _____ $|\mathbf{b}| =$ _____

5 (c) Calculate the acute angle between **a** and **b**

Give your answer to the nearest degree.

[2 marks]

Do not write outside the box

6 (a) On the axes below, sketch the graph of

$$y = \cosh x$$

Indicate the value of any intercept of the curve with the axes.

[2 marks]

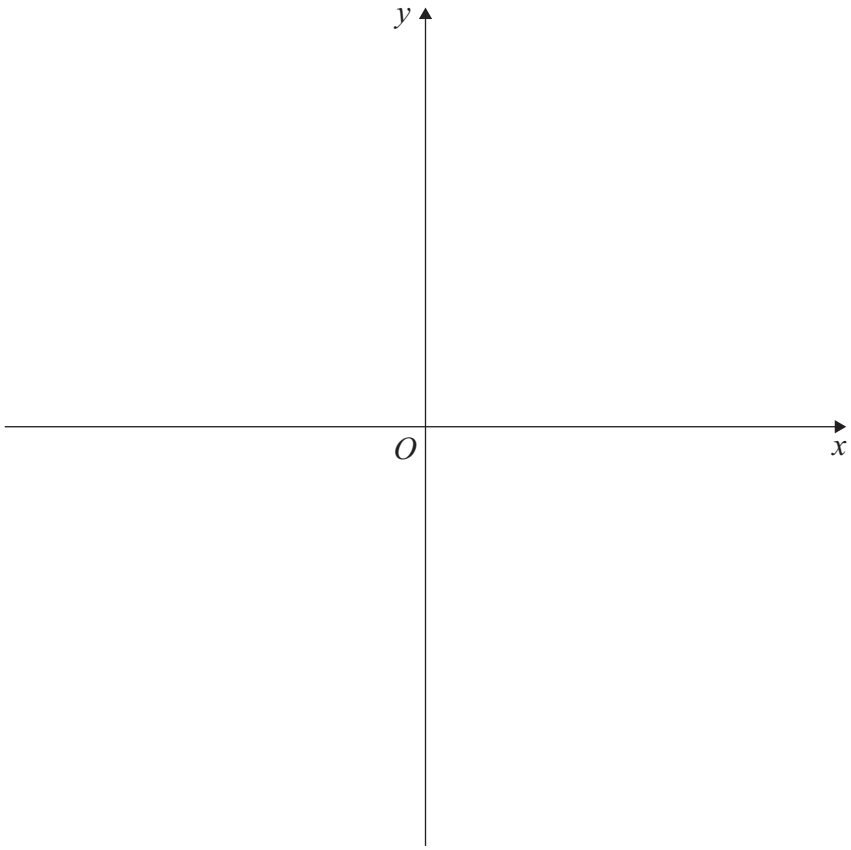

6 (b) Solve the equation

$$\cosh x = 2$$

Give your answers to three significant figures.

[2 marks]

Do not write outside the box

There are no questions printed on this page

DO NOT WRITE ON THIS PAGE
ANSWER IN THE SPACES PROVIDED

Do not write outside the box

7 The function f is defined by

$$f(x) = \frac{1}{\sqrt{x}} \qquad 4 \leq x \leq 7$$

Find the mean value of f over the interval $4 \leq x \leq 7$

Give your answer in exact form.

[3 marks]

Do not write outside the box

8 (a) The complex number z is given by $z = x + \mathrm{i}y$ where $x, y \in \mathbb{R}$

8 (a) (i) Write down the complex conjugate z^* in terms of x and y

[1 mark]

8 (a) (ii) Hence prove that zz^* is real for all $z \in \mathbb{C}$

[2 marks]

Do not write outside the box

8 (b) The complex number w satisfies the equation

$$3w + 10\mathrm{i} = 2w^* + 5$$

8 (b) (i) Find w

[3 marks]

8 (b) (ii) Calculate the value of $w^2(w^*)^2$

[1 mark]

Do not write outside the box

9 (a) Show that, for all positive integers r,

$$\frac{r+1}{r+2} - \frac{r}{r+1} = \frac{1}{(r+1)(r+2)}$$

[1 mark]

9 (b) Hence, using the method of differences, show that

$$\sum_{r=1}^{n} \frac{1}{(r+1)(r+2)} = \frac{n}{an+b}$$

where a and b are integers to be determined.

[3 marks]

Do not write outside the box

9 (c) Hence find the exact value of

$$\sum_{r=1001}^{2000} \frac{1}{(r+1)(r+2)}$$

[3 marks]

Do not write outside the box

10 The curve C has equation

$$y = \frac{2x - 10}{3x - 5}$$

Figure 1 shows the curve C with its asymptotes.

Figure 1

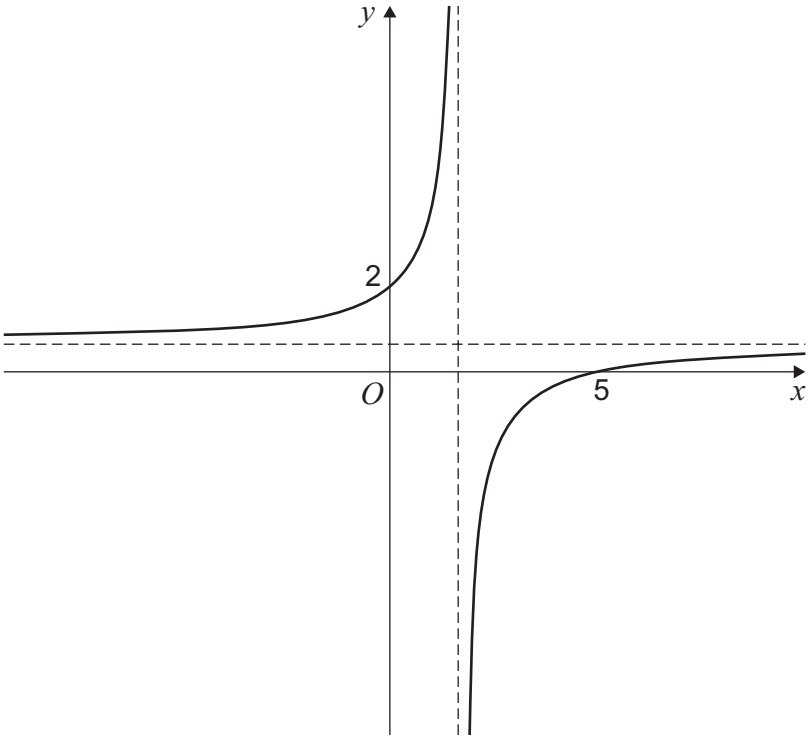

10 (a) Write down the equations of the asymptotes of C

[2 marks]

Do not write outside the box

10 (b) The line L has equation

$$y = -\frac{2}{5}x + 2$$

10 (b) (i) Draw the line L on **Figure 1**

[2 marks]

10 (b) (ii) Hence, or otherwise, solve the inequality

$$\frac{2x - 10}{3x - 5} \leq -\frac{2}{5}x + 2$$

[2 marks]

Turn over for the next question

Do not write outside the box

11 The matrices **A** and **B** are given by

$$\mathbf{A} = \begin{bmatrix} 3\mathrm{i} & -2 \\ a & -\mathrm{i} \end{bmatrix} \qquad \text{and} \qquad \mathbf{B} = \begin{bmatrix} 4 & 5 \\ -2\mathrm{i} & -1 \end{bmatrix}$$

where a is a real number.

Calculate the product **AB** in terms of a

Give your answer in its simplest form.

[3 marks]

Do not write outside the box

12 Prove by induction that, for all $n \in \mathbb{N}$, the expression

$$5^n - 2^n$$

is divisible by 3

[4 marks]

Do not write outside the box

13 The cubic equation $x^3 - x - 7 = 0$ has roots α, β and γ

The cubic equation $\mathrm{p}(x) = 0$ has roots $\alpha - 1$, $\beta - 1$ and $\gamma - 1$

The coefficient of x^3 in $\mathrm{p}(x)$ is 1

13 (a) Describe fully the transformation that maps the graph of $y = x^3 - x - 7$

onto the graph of $y = \mathrm{p}(x)$

[2 marks]

13 (b) Find $\mathrm{p}(x)$

[3 marks]

Do not write outside the box

Turn over for the next question

Do not write outside the box

14 The matrix **M** represents the transformation T, and is given by

$$\mathbf{M} = \begin{bmatrix} 3 & -1 \\ -2 & 6 \end{bmatrix}$$

14 (a) The point A has coordinates $(4, -5)$

Find the coordinates of the image of A under T

[2 marks]

14 (b) Show that the only invariant point under T is the origin.

[3 marks]

Do not write outside the box

14 (c) The line L_1 has equation $y = x + 1$

The transformation T maps the line L_1 onto the line L_2

Find the equation of L_2 in the form $y = mx + c$

[5 marks]

Do not write outside the box

15 (a) Use Maclaurin's series expansion for $\ln(1 + x)$ to show that the first three terms of the Maclaurin's series expansion of $\ln(1 + 3x)$ are

$$3x - \frac{9}{2}x^2 + 9x^3$$

[1 mark]

15 (b) Julia attempts to use the series expansion found in part **(a)** to find an approximation for $\ln 4$

Julia's incorrect working is shown below.

$$\begin{aligned} \text{Let } 1 + 3x &= 4 \\ 3x &= 3 \\ x &= 1 \end{aligned}$$

$$\begin{aligned} \text{So } \ln 4 &\approx 3 \times 1 - \frac{9}{2} \times 1^2 + 9 \times 1^3 \\ &\approx 3 - 4.5 + 9 \\ &\approx 7.5 \end{aligned}$$

Explain the error in Julia's working.

[2 marks]

Do not write outside the box

15 (c) Use $x = -\frac{1}{6}$ in the series expansion found in part **(a)** to find an approximation for $\ln 4$

Fully justify your answer.

[4 marks]

Do not write outside the box

16 The curve C has the polar equation

$$r = \frac{2}{\sqrt{\cos^2\theta + 4\sin^2\theta}} \qquad -\pi < \theta \leq \pi$$

16 (a) Show that the Cartesian equation of C can be written as

$$\frac{x^2}{a^2} + \frac{y^2}{b^2} = 1$$

where a and b are positive integers to be determined.

[4 marks]

Do not write outside the box

16 (b) Hence sketch the graph of C on the axes below.

Indicate the value of any intercepts of the curve with the axes.

[2 marks]

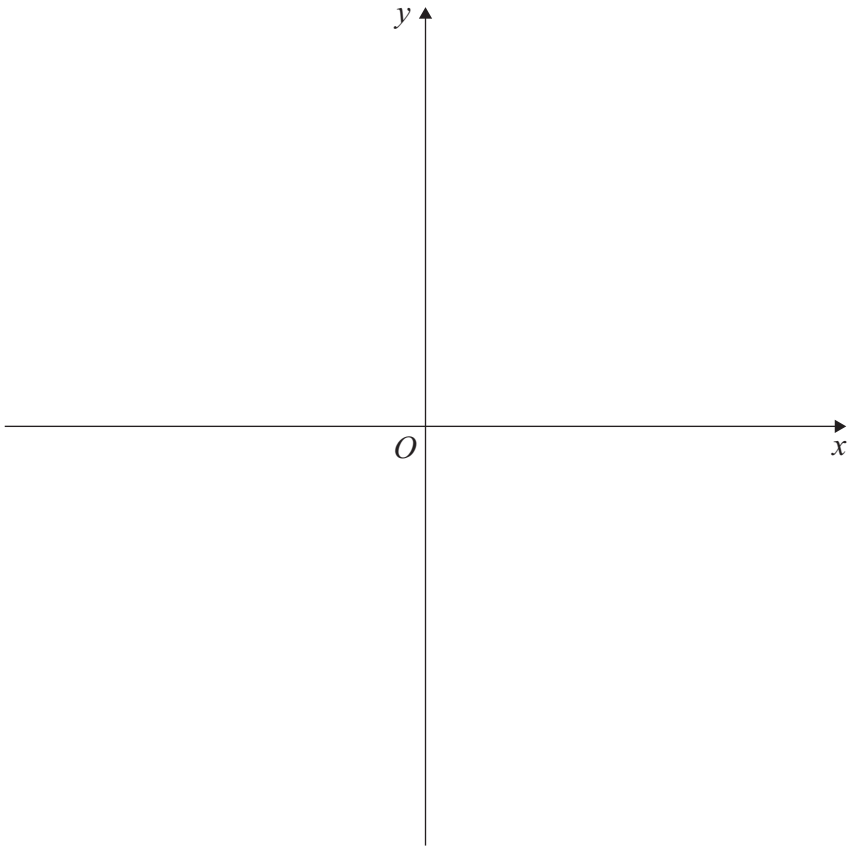

Turn over for the next question

Do not write outside the box

17 The circle C represents the locus of points satisfying the equation

$$|z - a\mathrm{i}| = b$$

where a and b are real constants.

The circle C intersects the imaginary axis at $2\mathrm{i}$ and $8\mathrm{i}$

The circle C is shown on the Argand diagram in **Figure 2**

Figure 2

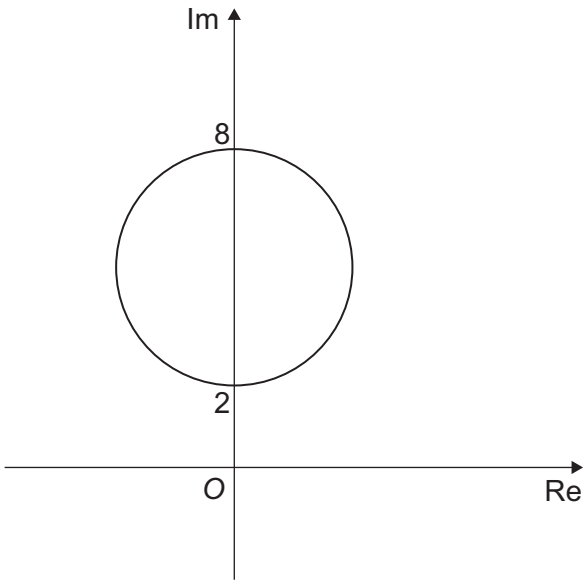

17 (a) (i) Write down the value of a

[1 mark]

17 (a) (ii) Write down the value of b

[1 mark]

Do not write outside the box

17 (b) The half-line L represents the locus of points satisfying the equation

$$\arg(z) = \tan^{-1}(k)$$

where k is a positive constant.

The point P is the **only** point which lies on both C and L, as shown in **Figure 3**

Figure 3

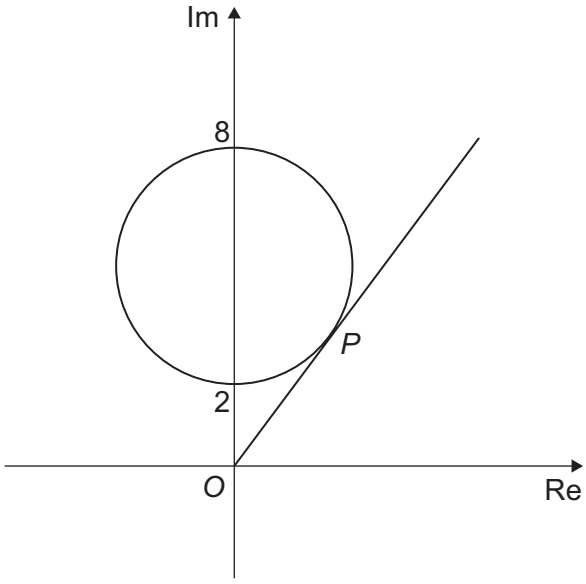

17 (b) (i) The point O represents the number $0 + 0\mathrm{i}$

Calculate the length OP

[2 marks]

Do not write outside the box

17 (b) (ii) Calculate the exact value of k

[2 marks]

17 (b) (iii) Find the complex number represented by point P

Give your answer in the form $x + y\mathrm{i}$ where x and y are real.

[3 marks]

Do not write outside the box

END OF QUESTIONS

Do not write outside the box

There are no questions printed on this page

DO NOT WRITE ON THIS PAGE
ANSWER IN THE SPACES PROVIDED

Do not write outside the box

Question number	**Additional page, if required.** **Write the question numbers in the left-hand margin.**

Do not write outside the box

Question number	**Additional page, if required.** **Write the question numbers in the left-hand margin.**

Do not write outside the box

Question number	Additional page, if required. Write the question numbers in the left-hand margin.

Do not write outside the box

Question number	Additional page, if required. Write the question numbers in the left-hand margin.

Copyright information

For confidentiality purposes, all acknowledgements of third-party copyright material are published in a separate booklet.
This booklet is published after each live examination series and is available for free download from www.aqa.org.uk.

Permission to reproduce all copyright material has been applied for. In some cases, efforts to contact copyright-holders may have been unsuccessful and AQA will be happy to rectify any omissions of acknowledgements. If you have any queries please contact the Copyright Team.

Copyright © 2024 AQA and its licensors. All rights reserved.